Chaque jour compte

___c___d___u

cent-onze

110 120

... < 111 < ...

+ +

Impair Pair

Egun bakoitza konta da

___e___h___b

ehun eta hamaika

110 120

... < 111 < ...

+ +

Bakoiti Bikoiti

Chaque jour compte

___c___d___u

cent-douze

110 120

... < 112 < ...

+ +

Impair Pair

Egun bakoitza konta da

___e___h___b

ehun eta hamabi

110 120

... < 112 < ...

+ +

Bakoiti Bikoiti

Chaque jour compte

___c___d___u

Florent

cent-treize





110 120

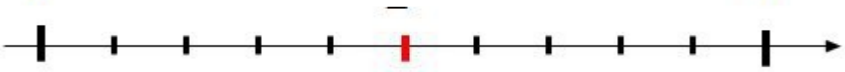

... < 113 < ...

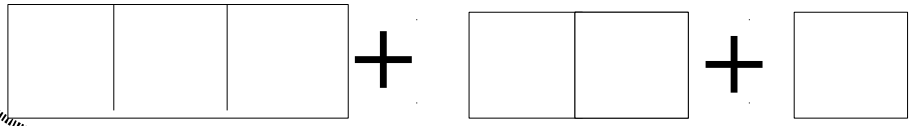

Impair Pair

Egun bakoitza konta da

___e___h___b

Florent

ehun eta hamahiru





110 120



... < 113 < ...

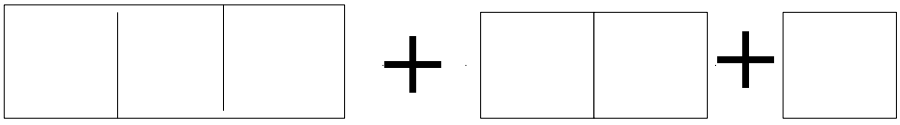

Bakoiti Bikoiti

Chaque jour compte

___c___d___u

cent-quatorze

110 120

... < 114 < ...

+ +

Impair Pair

Egun bakoitza konta da

___e___h___b

ehun eta hamalau

110 120

... < 114 < ...

+ +

Bakoiti Bikoiti

Chaque jour compte

c d u

cent-quinze





110 120

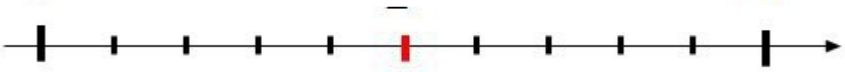

... < 115 < ...

+ +

Impair Pair

Egun bakoitza konta da

e h b

ehun eta hamabost





110 120



... < 115 < ...

+ +

Bakoiti Bikoiti

Chaque jour compte

c	d	u

cent-seize

110 120

... < 116 < ...

+ +

Impair Pair

Egun bakoitza konta da

e	h	b

ehun eta hamasei

110 120

... < 116 < ...

+ +

Bakoiti Bikoiti

Chaque jour compte

___c___d___u

cent-dix-sept

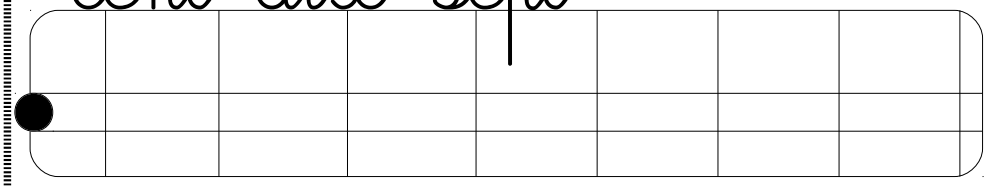



110 120

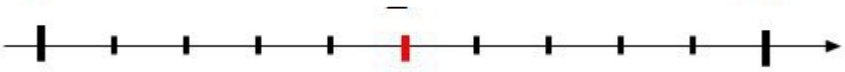

... < 117 < ...

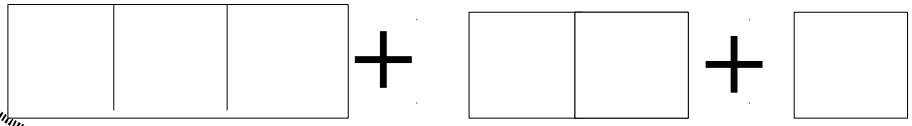

Impair Pair

Egun bakoitza konta da

___e___h___b

ehun eta hamazazpi





110 120



... < 117 < ...

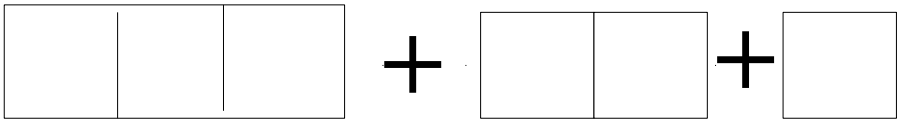

Bakoiti Bikoiti

Chaque jour compte

___c___d___u

cent-dix-huit

110 120

... < 118 < ...

+ +

Impair Pair

Egun bakoitza konta da

___e___h___b

ehun eta hemezortzi

110 120

... < 118 < ...

+ +

Bakoiti Bikoiti

Chaque jour compte

___c___d___u

cent-dix-neuf

110 120

... < 119 < ...

+ +

Impair Pair

Egun bakoitza konta da

___e___h___b

ehun eta hemeretzi

110 120

... < 119 < ...

+ +

Bakoiti Bikoiti

Chaque jour compte

___c___d___u

cent-vingt

110 120

... < 120 < ...

+

Impair Pair

Egun bakoitza konta da

___e___h___b

ehun eta hogei

110 120

... < 120 < ...

+

Bakoiti Bikoiti